© 2015 Kuta Software LLC. All rights reserved.

Find the slope of each line.

1)

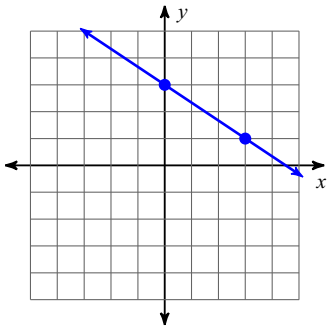

2)

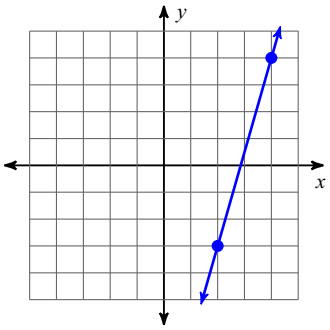

3)

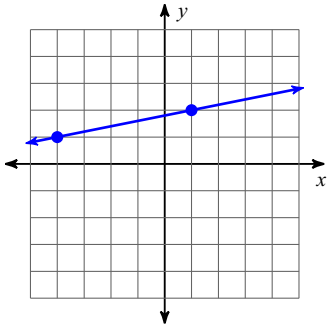

4)

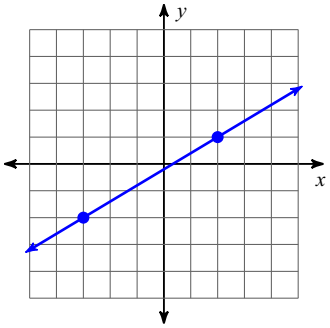

5)

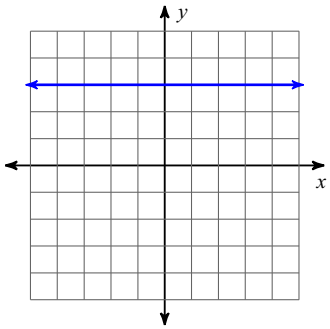

6)

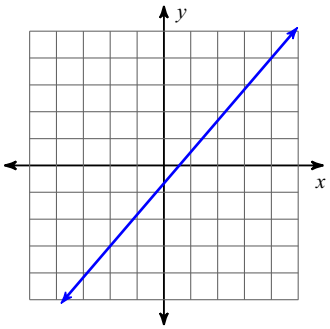

7)

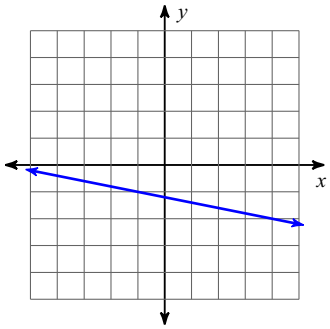

8)

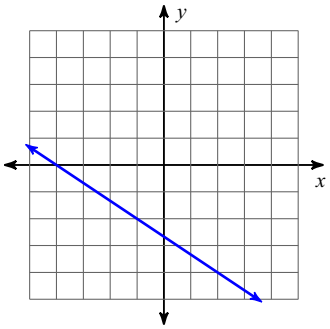

Find the slope of the line through each pair of points.

9) $(0, -11), (16, -4)$

10) $(-17, 12), (8, 3)$

11) $(-13, 0), (19, 8)$

12) $(-6, -11), (-5, -11)$

13) $(1, 19), (-16, 1)$

14) $(-16, -7), (-1, 6)$

15) $(0, 11), (12, 9)$

16) $(5, -16), (15, -1)$

17) $(-20, 16), (-13, 15)$

18) $(0, 9), (5, 9)$

19) $(16, -14), (16, 20)$

20) $(0, -12), (14, -6)$

© 2015 Kuta Software LLC. All rights reserved. Made with Infinite Pre-Algebra.